All rights reserved. No part of this publication may be reproduced, distributed, or transmitted in any form or by any means, electronic, mechanical, photocopying, recording or otherwise, or stored in any retrieval system of any nature without the permission of cracku.in, application for which shall be made to support@cracku.in

Downloaded from cracku.in

SSC CHSL 10th March 2023 Shift-2

English Language

1. **Select the word that is closest in meaning (SYNONYM) to the word given below.**
   ANXIOUS

A COLLECTED

B APPREHENSIVE

C ACCEPT

D FLAWLESS

Answer: B

2. **Select the most appropriate meaning of the given idiom.**
   Slack off

A To understand a hidden meaning

B To ease pressure on something

C To make most effort

D To be very rude

Answer: B

3. **Improve the underlined part of the sentence. Choose 'No improvement' as an answer if the sentence is grammatically correct.**
   This heap of rubbish has not <u>been remove for</u> 6 months.

A No improvement

B been removing from

C been removes since

D been removed for

Answer: D

4. **Choose the option that is the correct indirect form of the sentence.**
   My mother said, "I am meeting your father today."

A My mother said that she were meeting my father that day.

B My mother says that she was meeting my father today.

Downloaded from cracku.in

C The mother said that she has been meeting my father that day.

D My mother said that she was meeting my father that day.

Answer: D

SSC CHSL Free Mock Test

5. **Find the part of the given sentence that has an error in it. If there is no error, choose 'No error'.**
When we cook garlic, the sulphide molecules raise into the air and fill the room with their pleasing aroma.

A When we cook garlic, the sulphide

B molecules raise into the air

C No error

D and fill the room with their pleasing aroma.

Answer: B

6. **Rearrange the parts of the sentence in correct order.**
If a product placement
P. we are either less likely to notice the placement
Q. our attention is fixated on what will happen next,
R. or more likely to be annoyed by it if we do notice it
S. appears at the climax, the moment when

A RSQP

B SPQR

C SQPR

D PRSQ

Answer: C

7. **Fill in the blank with an appropriate option.**
He was a handsome man in his _____ thirties.

A late

B lest

C latter

D least

Downloaded from cracku.in

Answer: A

SSC CHSL Prevoius Papers (DOWNLOAD PDF)

8. **Select the option that will improve the underlined part of the sentence. In case no improvement is needed, select 'No improvement'.**
Africa has glaciers on the Mount Kilimanjaro in Tanzania and on the Mount Kenya.

A Mount Kilimanjaro in Tanzania and the Mount Kenya

B Mount Kilimanjaro in Tanzania and on Mount Kenya

C No improvement

D the Mount Kilimanjaro in Tanzania and to Mount Kenya

Answer: B

9. **Select the most appropriate one-word substitution for the given group of words.**
Recovering from an illness or medical treatment.

A Bohemian

B Connoisseur

C Convalescent

D Cosmopolitan

Answer: C

10. **Some parts of a few sentences have been jumbled up, and labelled A, B, C and D. Select the option that gives the correct sequence in which these parts can be rearranged to form a meaningful and grammatically correct sentence.**
There were two final
A. the story was the tale of Kunti
B. a story and a parchment.
C. gifts the sorceress gave me
D. mother of Arjun. The parchment was a map of Bharat's many kingdoms

A ADCB

B CBAD

C DCBA

D ABCD

Answer: B

Downloaded from cracku.in

11. **Parts of the following sentence are given as options. Identify the part that contains a grammatical error. If there is no error, select 'No error'.**
This was no strange sight / to the boy by that time, / for he had neither gun or spear.

A No error

B for he had neither gun or spear.

C to the boy by that time,

D This was no strange sight

Answer: B

12. **Choose the word that means the same as the given word.**
Gallivant

A Meander

B Grave

C Gall

D Brave

Answer: A

13. **Select the correct passive form of the given sentence.**
Meghna has taken all the cash.

A All the cash had been taken by Meghna.

B All the cash has been taken by Meghna.

C All the cash had been taking by Meghna.

D All the cash was taken by Meghna.

Answer: B

SSC CGL Free Mock Test (Latest Pattern)

14. **Select the word that is similar in meaning (SYNONYM) to the word given below**
Glib

A Inarticulate

B Implausible

Downloaded from cracku.in

C Easy

D Sincere

Answer: C

15. **In the following question, out of the given four alternatives, select the alternative which best expresses the meaning of the Idiom/Phrase.**
Pig in a poke

A To bring something to an end

B A brave man amongst all the cowards

C Something that is bought without examining properly

D To obstruct someone's work

Answer: C

16. **Select the word that is opposite in meaning (ANTONYM) to the word given below.**
Fiend

A Vile

B Junkie

C Saint

D Atrocious

Answer: C

SSC CHSL Important Questions and Answers (Download PDF)

17. **Rearrange the parts of the sentence in correct order.**
The researchers
P. performed experiments and developed a model
Q. which explains how the worm's taste sensors
R. to direct its foraging behaviour
S. process information from the environment

A RPQS

B PQSR

C PSQR

D PRQS

Answer: B

Downloaded from cracku.in

18. **Select the word segment that substitutes (replaces) the bracketed word segment correctly and completes the sentence meaningfully. In case no improvement is needed, select 'No improvement'. (Hardly had the news leak out that) my telephone started ringing.**

A No sooner did the news leaked out than

B No sooner had the news leaked out than

C No sooner had the news leaked out that

D No improvement

Answer: B

19. **Choose the incorrectly spelt word.**

A VISCOUS

B BENEVOLENT

C PERCIEVE

D BOISTEROUS

Answer: C

SSC CHSL Study Material

20. **Choose the correctly spelt word.**

A VACILLATE

B STILLETOES

C OBSEQUIOS

D MAINTAINANCE

Answer: A

Instructions [21 - 25]

In the following passage some words have been deleted. Fill in the blanks with the help of the alternatives given. Select the most appropriate option for each number.

Comprehension:
Through the (1) _____ , lonely years of my childhood, when my father's palace (2) _____ to tighten its grip (3) _____ me until I couldn't (4) _____, I would go to my nurse and ask for a story. And though she knew many wondrous and edifying tales, the one I made her tell me over and over was the (5) _____ of my birth.

21. **Select the most appropriate option to fill in the blank No. 1.**

Downloaded from cracku.in

A long

B timid

C menial

D beautiful

Answer: A

22. **Select the most appropriate option to fill in the blank No. 2.**

A seemed

B perhaps

C besides

D thought

Answer: A

SSC CHSL Free App

23. **Select the most appropriate option to fill in the blank No. 3.**

A encompassing

B revolving

C surround

D around

Answer: D

24. **Select the most appropriate option to fill in the blank No. 4.**

A breath

B breathed

C breathing

D breathe

Answer: D

25. **Select the most appropriate option to fill in the blank No. 5.**

A poem

Downloaded from cracku.in

B story

C ode

D news

Answer: B

Daily Free SSC Practice Set

General Intelligence

26. **If 64 # 58 # 32 = -26 and 104 # 17 # 89 = -2, then 56 # 7 # 24 = ?**

A 21

B 25

C -2

D -13

Answer: B

Free SSC Study Material (18,000 Solved Questions)

27. **In a certain code language, 'DO' is written as '60' and 'PIE' is written as '720'. How will 'CAT' be written in that code language?**

A 120

B 60

C 720

D 180

Answer: B

28. **Words given on the left side of (::) are related with each other by some Logic/Rule /Relation. Select the missing word/word pair on the right side of (::) from the given alternatives based on the same Logic/Rule/Relation.**
Site : Engineer :: ?

A Waiter : Restaurant

B Grocer : Shop

C Scientist : Laboratory

D House : Servant

Downloaded from cracku.in

Answer: D

29. **Select the word pair in which the words are related in the same way as the words are related in the following pair.**
Bhutan : Thimphu

A Rome : Italy

B China : Hong Kong

C Pakistan : Islamabad

D Bangladesh : Taka

Answer: C

1500+ Very Important Free SSC Solved Questions

30. **In the question three statements are given, followed by two conclusions, I and II. You have to consider the statements to be true even if they seem to be at variance from commonly known facts. You have to decide which of the given conclusions, if any, follows from the given statements.**
Statements:
I.Some walls are broken.
II.All windows are broken.
III.Some walls are not painted.
Conclusions:
I. Some broken are windows.
II. All windows are painted.

A Only conclusion II follows.

B Only conclusion I follows.

C Both conclusion I and II follow.

D Neither conclusion I nor II follow.

Answer: B

31. **After arranging the given words according to dictionary order, which word will come at 'Fourth' position?**
1. Activity
2. Activist
3. Activismal
4. Activisticy
5. Activize

A Activismal

B Activist

Downloaded from cracku.in

C Activity

D Activize

Answer: C

32. **Select the figure that will come next in the following figure series.**

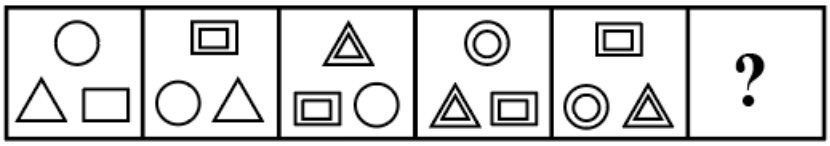

A

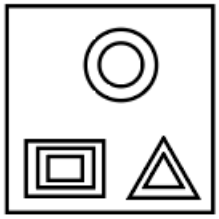

B

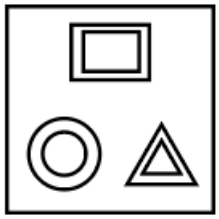

C

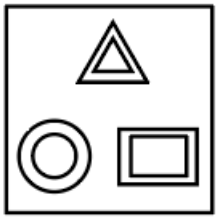

D

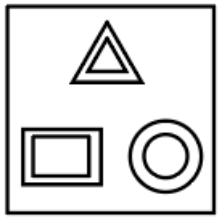

Answer: D

SSC Exam Update Videos & Free Study Material (YouTube Channel)

33. **By interchanging the given two signs which of the following equation will be not correct?**
+ and -
I. $18 \div 3 + 8 \times 5 - 4 = 20$
II. $6 + 8 \times 9 \div 3 - 4 = 14$

A Neither I nor II

B Only II

C Only I

Downloaded from cracku.in

D Both I and II

Answer: D

34. **In a certain code language, 'CEMENT' is written as 'ECOCPR' and 'HEIGHT' is written as 'JCKEJR'. How will 'FATHER' be written in that language?**

A HZVFGP

B HYVFGO

C HYVEGP

D HYVFGP

Answer: D

35. **Select the option that is related to the fifth number in the same way as the second number is related to the first number and fourth number is related to third number.**
58 : 319 :: 32 : 176 :: 76 : ?

A 442

B 286

C 428

D 418

Answer: D

Latest Job Updates on Telegram - Join here

36. **Study the given diagram carefully and answer the questions. The numbers in different sections indicate the number of persons. How many people are educated and rich but not famous?**

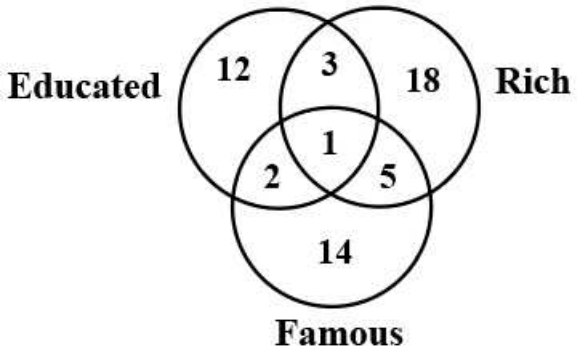

A 2

B 5

C 3

Downloaded from cracku.in

D 1

Answer: C

37. **In the following question, four number pairs are given. In each pair the number on left side of (-) is related to the number of the right side of (-) with some Logic/Rule /Relation. Three pairs are similar on basis of same Logic/Rule/Relation. Select the odd one out from the given alternatives. (NOTE: Operations should be performed on the whole numbers, without breaking down the numbers into its constituent digits. E.g.13 - Operations on 13 such as adding /subtracting /multiplying etc. to 13 can be performed. Breaking down 13 into 1 and 3 and then performing mathematical operations on 1 and 3 is not allowed)**

A 331235 - 66247

B 15265 - 3053

C 51265 - 10253

D 126215 - 25247

Answer: D

38. **Select the option figure in which the given figure is embedded. (rotation is NOT allowed)**

A

B

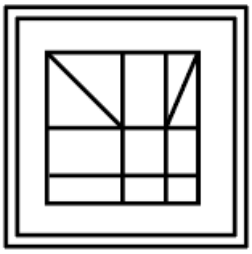

C

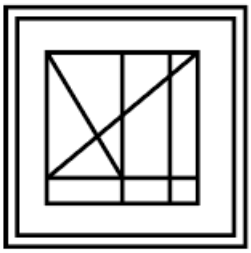

Downloaded from cracku.in

D 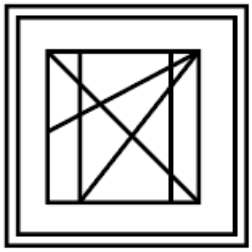

Answer: A

Join SSC Daily Quiz Telegram Group

39. **In the following question, select the related letters from the given alternatives.**
RV : TE :: EL : ?

A LU

B GO

C NC

D DP

Answer: B

40. **Which one set of letters when sequentially placed at the gaps in the given letter series shall complete it?**
A A _ A B _ A B C _ A _ C _ E

A BCCBD

B BCDBD

C AABCD

D BABCD

Answer: B

41. **Select the option figure in which the given figure is embedded. (rotation is NOT allowed)**

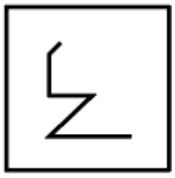

Downloaded from cracku.in

A 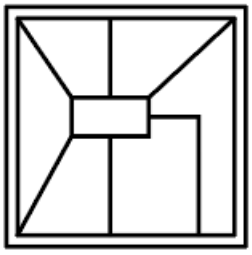

B 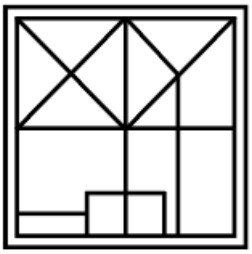

C 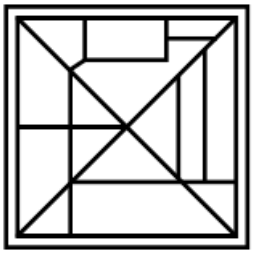

D 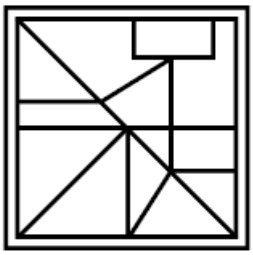

Answer: C

42. **N is the brother of Y and Y is the sister of B. B is the wife of Z and C is the mother of Y. How Z is related to C?**

A Son-in-law

B Daughter

C Maternal Uncle

D Sister

Answer: A

43. **Select the correct mirror image of the given combination when the mirror is placed at line AB as shown.**

Downloaded from cracku.in

A

B

C

D

Answer: D

44. **Select the option in which the numbers shares the same relationship in set as that shared by the numbers in the given set. (NOTE: Operations should be performed on the whole numbers, without breaking down the numbers into its constituent digits. E.g.13 - Operations on 13 such as adding /subtracting /multiplying etc. to 13 can be performed. Breaking down 13 into 1 and 3 and then performing mathematical operations on 1 and 3 is not allowed)**
(8, 63, 81)
(11, 120, 144)

A (9, 80, 100)

B (6, 36, 49)

C (5, 24, 49)

D (7, 48, 96)

Answer: A

SSC CHSL Free Mock Test

45. **Three of the following four letter clusters are alike in a certain way and one is different.Pick the cluster that is different from the rest.**

A HS

B CX

C MN

D JP

Answer: D

46. **In the following question, select the missing number from the given series.**
48, 87, 165, 204, 282, 321, ?

A 399

B 389

Downloaded from cracku.in

C 419

D 409

Answer: A

47. **In the following question, four number pairs are given. In each pair the number on left side of (-) is related to the number of the right side of (-) with some Logic/Rule /Relation. Three pairs are similar on basis of same Logic/Rule/Relation. Select the odd one out from the given alternatives. (NOTE: Operations should be performed on the whole numbers, without breaking down the numbers into its constituent digits. E.g.13 - Operations on 13 such as adding /subtracting /multiplying etc. to 13 can be performed. Breaking down 13 into 1 and 3 and then performing mathematical operations on 1 and 3 is not allowed)**

A 108 - 11664

B 116 - 13456

C 112 - 12544

D 104 - 10886

Answer: D

SSC CHSL Prevoius Papers (DOWNLOAD PDF)

48. **Select the option figure in which the given figure is embedded. (Rotation is NOT allowed).**

A

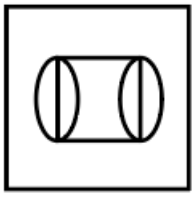

B

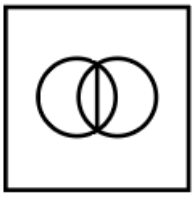

C

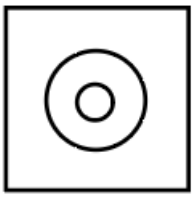

Downloaded from cracku.in

D 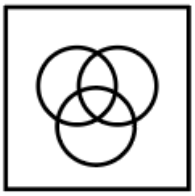

Answer: A

49. **Find the total number of triangles in the figure.**

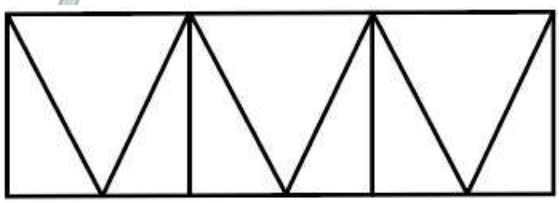

A 12

B 9

C 11

D 10

Answer: C

50. **In the following question, select the odd word pair from the given alternatives.**

A Poem - Poet

B Ornament - Goldsmith

C Clothes - Tailor

D Carpenter - Furniture

Answer: D

SSC CGL Previous Papers (DOWNLOAD PDF)

Quantitative Aptitude

51. **If A alone can complete a work in 20 days and B alone can complete the same work in 30 days, then which of the following statement(s) is/are correct?**
I. Ratio of efficiency of A and B is 3 : 2.
II. Working together A and B can complete the same work in 12 days.

A Neither I nor II

B Both I and II

C Only II

Downloaded from cracku.in

D Only I

Answer: B

SSC CGL Free Mock Test (Latest Pattern)

52. **The Bar graph shows four different toys (Bicycle, Train, Car & Bus) manufactured by ABC Pvt Ltd. company in 3 consecutive years.**

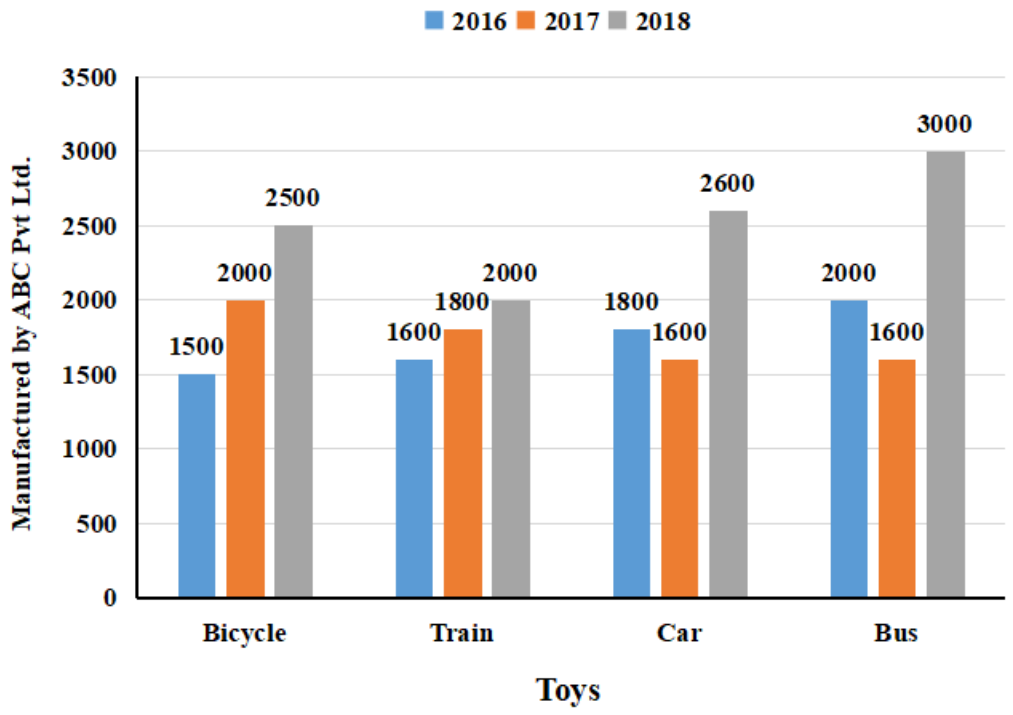

What is the ratio between the sum of cars and trains manufactured in 2017 and 2018 to the total number of buses manufactured in 2016, 2017 and 2018 together ?

A 30 : 41

B 33 : 40

C 35 : 41

D 40 : 33

Answer: D

53. **The length of rectangular sheet of paper is 24 cm more than the breadth and perimeter of the rectangular sheet is 128 cm. Find the length of the rectangular sheet.**

A 20 cm

B 44 cm

C 48 cm

D 34 cm

Downloaded from cracku.in

Answer: B

54. **Rs. 6000 is lent at the annual rate of 10 percent for 2 years. Which of the following is statement(s) is/are correct?**
I. Simple interest to be received on this sum is Rs. 1200
II. Compound interest (compounding annually) to be received on this sum is Rs. 1260

A Statement I is correct

B Both statement I and II are correct

C Statement II is correct

D None of them are correct

Answer: B

SSC CHSL Important Questions and Answers (Download PDF)

55. **If $\tan\theta + \cot\theta = 2$, then what is the value of $\tan\theta - \cot\theta$?**

A 0

B $\frac{5}{8}$

C 1

D $\frac{3}{4}$

Answer: A

56. **If (a - b) = 5 and ab = 150, then what is the value of $(a^3 - b^3)$?**

A 2640

B 1125

C 2375

D 2250

Answer: C

Downloaded from cracku.in

57. **The following line graph shows the annual profit percentage earned by a company during the years 2016 to 2020. What is the average profit percent earned by the company during the years 2016 to 2020?**

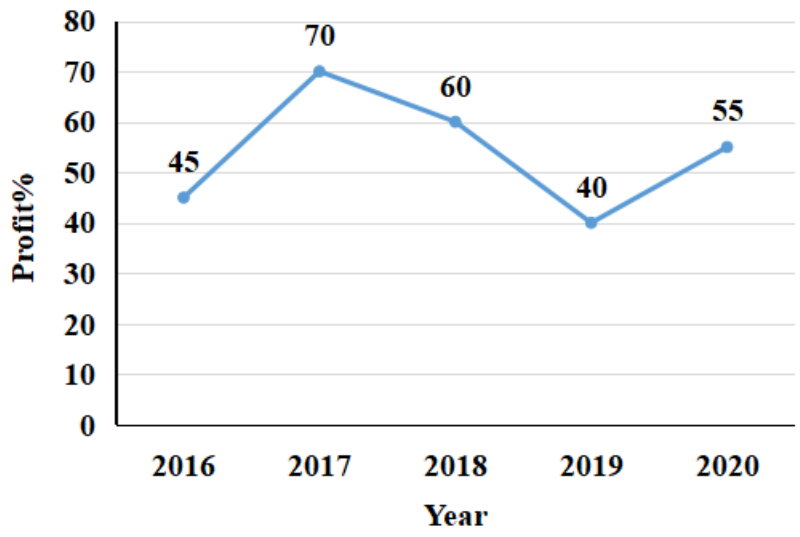

A 55%

B 44%

C 48%

D 54%

Answer: D

SSC CHSL Study Material

58. **A wheel makes 500 revolutions in covering a distance of 44 km. Find the radius of the wheel.**

A 14 m

B 21 m

C 28 m

D 7 m

Answer: A

59. **Length of chord MN is 40 cm. Distance of chord MN from the centre is 15 cm. What will be the radius of this circle?**

A 42 cm

B 32 cm

C 30 cm

Downloaded from cracku.in

D 25 cm

Answer: D

60. **What is** $\frac{\text{cosec } 90^\circ}{1-\cos^2 60^\circ}$

A 0

B $\frac{4}{3}$

C $\frac{1}{4}$

D $\frac{3}{4}$

Answer: B

SSC CHSL Free App

61. **Find the value of** $1200 \div 15 \times [45 \div (17-2)] of 2 + [-2(1+2)]$.

A 486

B 0

C 484

D 474

Answer: D

62. **The table given below shows the number of male teacher and female teachers in 5 schools.**

School	Male teachers	Female teachers
J	180	240
K	240	210
L	210	60
M	150	30
N	90	90

Which of the following statement is correct?
I. The number of male teachers in school L is 135.44 percent of the number of female teachers in school P.
II. The ratio of number of female teachers in M and N together to the number of male teachers in N and P together is 29:32

A Only II

Downloaded from cracku.in

B Neither I nor II

C Both I and II

D Only I

Answer: A

63. **In the Lok Sabha election, Party A got 30% of the total votes. Party B got 25% of the total votes. Party C got the remaining votes and they got 9000 more votes than Party A. Find the number of votes Party B got.**

A 12000

B 18000

C 21000

D 15000

Answer: D

Daily Free SSC Practice Set

64. **If** $\sin x = \frac{1}{2}$**, then find the value of** $(\sec^4 x + \operatorname{cosec}^4 x) - (\tan^4 x + \cot^4 x)$.

A $\frac{26}{3}$

B $\frac{97}{12}$

C $\frac{26}{23}$

D 2

Answer: A

65. **How many prime numbers are there between 20 and 50?**

A 8

B 5

C 6

D 7

Answer: D

66. **If** $2p + 5q = 12$ **and** $pq = 3$**, find the value of** $4p^2 + 25q^2$.

A 64

Downloaded from cracku.in

B 24

C 84

D 44

Answer: C

Free SSC Study Material (18,000 Solved Questions)

67. **In a triangle ABC, AB = 6 cm, BC = 11 cm. How many integral values of AC can be possible?**

A 10

B 8

C 12

D 11

Answer: D

68. **The table given below shows the cost price and value of profit of 6 articles.**

Articles	Cost price	Profit
D	700	200
E	600	150
F	400	300
G	500	400
H	300	250
I	800	350

Which of the following statement is NOT correct?
I. The profit of D, E and F is 30.63 percent of the cost price of G, H and I.
II. The ratio of total cost price to the total profit is 1 : 2.

A Both I and II

B Only II

C Only I

D Neither I nor II

Answer: A

69. **A family consists of a father, mother and son. The ratio of their present ages is 8 : 5 : 2 and the present age of the father is 48 years. What will be the average age of family after 3 years?**

Downloaded from cracku.in

A 30 years

B 31 years

C 33 years

D 35 years

Answer: C

1500+ Very Important Free SSC Solved Questions

70. **What is the equivalent single discount of two successive discounts of 12% and 10%?**

A 18 percent

B 20 percent

C 18.5 percent

D 20.8 percent

Answer: D

71. **Janki purchased 10 dozens of corn at the rate of Rs. 180 per dozen. She sold each corn at the rate of Rs.22. What was her percent profit?**

A 46.6 percent

B 18.8 percent

C 37.7 percent

D 25.5 percent

Answer: A

72. **What is the value of** $x^2 + 4y^2 + z^2 - 4xy + 4yz - 2xz$**?**

A $(x + 2y - z)^2$

B $(x - 2y + z)^2$

C $(2y - x + z)^2$

D $(2x - y + z)^2$

Answer: C

SSC Exam Update Videos & Free Study Material (YouTube Channel)

Downloaded from cracku.in

73. **The area (in cm^2) of biggest circle that could be drawn in a square of side 18 cm is:**

A 91 π

B 81 π

C 49 π

D 168 π

Answer: B

74. **If in the sales department of a company, the average salary per employee is Rs.350, average salary of 10 senior employees is Rs.450 per employee, and average salary of remaining staff is Rs.250 per employee, then what is the total number of employees working in the sales department?**

A 30

B 20

C 15

D 25

Answer: B

75. **Ram needs to reach the examination center in 6 hours, the journey itself is 250 km. If Ram has covered (3/5)th of the distance in 3.5 hours then what is the speed required to reach the destination 30 minutes early than the required time ?**

A 50 km/h

B 90 km/h

C 40 km/h

D 60 km/h

Answer: A

Latest Job Updates on Telegram - Join here

General Awareness

76. **The Planning Commission of India was replaced by NITI Aayog in _____.**

A 2016

B 2015

C 2018

Downloaded from cracku.in

D 2017

Answer: B

Join SSC Daily Quiz Telegram Group

77. **Who was the first female Muslim ruler of India?**

A Zebunnissa

B Razia Sultan

C Chand Bibi

D Jahanara

Answer: B

78. **Who received a Nobel Peace Prize for dismantling apartheid in South Africa?**

A Nelson Mandela

B Rabindranath Tagore

C Mahatma Gandhi

D Albert John Lutuli

Answer: A

79. **As of 2022, India is the _____ largest economy in the world (as measured by nominal GDP).**

A Third

B Second

C Fifth

D Fourth

Answer: C

80. **Raman wants to use a rear-view mirror in his vehicle. Which type of mirror should he pick for it?**

A Convex Mirrors

B Plane Mirrors

C Cylinderical Mirrors

D Concave Mirrors

Downloaded from cracku.in

Answer: A

81. **When was the Direct Tax Code Bill introduced in the Parliament of India?**

A 2010

B 2005

C 2020

D 2015

Answer: A

82. **Neeti wants to use an input device that works by sensing the user's finger movement and downward pressure. Which among the following should she use?**

A Scanner

B Touchpad

C Light pen

D Keyboard

Answer: B

SSC CHSL Free Mock Test

83. **Which country hosted the FIFA U-17 Women's World Cup 2022?**

A Egypt

B China

C France

D India

Answer: D

84. **Which of the following is NOT an application software?**

A Operating systems

B Graphics software

C Spreadsheet software

D Word-processing software

Answer: A

Downloaded from cracku.in

85. **Which among the following is another word for universe?**

A Big Crunch

B Astronomy

C Cosmos

D Supernova

Answer: C

SSC CHSL Prevoius Papers (DOWNLOAD PDF)

86. **"Pay Roll Automation for Disbursement of Monthly Allowances (PADMA)" was launched in June 2022 by Ministry of _____.**

A Civil Aviation

B Finance

C Defence

D Culture

Answer: C

87. **Who among the following received the OSCAR for the best actor in leading role in 2022?**

A Benedict Cumberbatch

B Andrew Garfield

C Denzel Washington

D Will smith

Answer: D

88. **In which year was the Dowry Prohibition Act passed in India?**

A 1973

B 1982

C 1961

D 1954

Answer: C

Downloaded from cracku.in

89. **PV Sindhu, a famous badminton player of India, won _____ Open title in July 2022.**

A Thailand

B India

C Denmark

D Singapore

Answer: D

90. **Who became the first athlete to win Gold in Yogasana at the 36th National Games, India in 2022?**

A Pooja Patel

B Manisha Kumari

C Soham Swami

D Raja Gupta

Answer: A

91. **In India, palm, coconut, keora, agar are the common trees of which of the following forests?**

A Mangrove Forests

B Tropical Evergreen Forests

C Tropical Deciduous Forests

D Montane Forests

Answer: A

SSC CGL Free Mock Test (Latest Pattern)

92. **In September 2022, who was appointed as the Attorney General of India?**

A Mukul Rohtagi

B Ram Jethmalani

C R Venkataramani

D KK Venugopal

Answer: C

Downloaded from cracku.in

93. **Which among the following lakes is also known as the "Srinagar's Jewel"?**

A Tsomgo

B Vembanad

C Dal

D Loktak

Answer: C

94. **Some what before the time of Mauryan empire, about _____ years ago, emperors in China began building the Great Wall.**

A 1200

B 3500

C 2400

D 600

Answer: C

SSC CHSL Important Questions and Answers (Download PDF)

95. **Shri Mani Prasad is associated with which form of music?**

A Fusion Music

B Folk Music

C Carnatic vocal music

D Hindustani vocal music

Answer: D

96. **Which among the following peaks is the highest peak of Jharkhand?**

A Kangto

B Girnar

C Anamudi

D Parasnath

Answer: D

97. **Which pass connects the Kullu Valley with the Lahaul and Spiti Valleys of Himachal Pradesh, India?**

Downloaded from cracku.in

A Banihal Pass

B Thamarassery Pass

C Rohtang Pass

D Lipulekh Pass

Answer: C

SSC CHSL Study Material

98. **Who among the following was the architect of the Integrated Guided Missile Development Program (IGMDP) in India?**

A Har Gobind Khorana

B Vikram Sarabhai

C A. P. J. Abdul Kalam

D Homi J. Bhabha

Answer: C

99. **Chikungunya is an infection caused by _____ mosquito.**

A Culex

B Mansonia

C Aedes

D Anopheles

Answer: C

00. **Aga Khan Palace is located in _____ city of Maharashtra.**

A Pune

B Aurangabad

C Ahmednagar

D Mumbai

Answer: A

SSC CHSL Free App

Downloaded from cracku.in

Downloaded from cracku.in